Completing and Matching Volume Equations Name:

**Match each problem with the equation that could represent it. Answer with the missing term and letter.**

**Ex)** 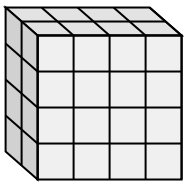

**1)** 

**2)** 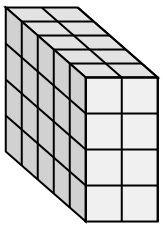

**3)** 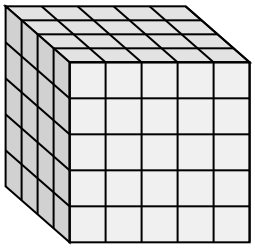

**4)** 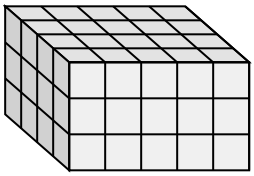

**5)** 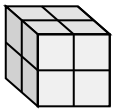

**6)** 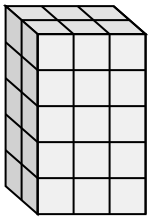

**7)** 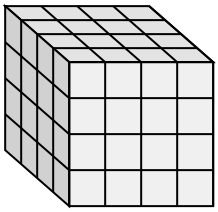

**8)** 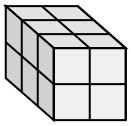

**9)** 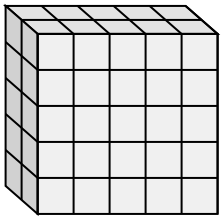

**10)** 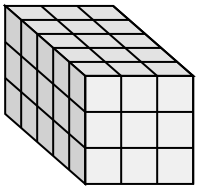

**11)** 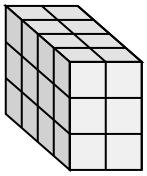

**A.** 4 × 5 × 3 = ___

**B.** 4 × ___ × 3 = 24

**C.** 2 × 3 × 5 = ___

**D.** ___ × 2 × 2 = 12

**E.** ___ × 5 × 5 = 50

**F.** ___ × 3 × 3 = 45

**G.** 5 × ___ × 4 = 40

**H.** 5 × 3 × 5 = ___

**I.** 4 × ___ × 4 = 64

**J.** 2 × ___ × 4 = 32

**K.** 4 × ___ × 5 = 100

**L.** 2 × ___ × 2 = 8

## Answers

Ex. J , 4

1. _____
2. _____
3. _____
4. _____
5. _____
6. _____
7. _____
8. _____
9. _____
10. _____
11. _____



| | | | | | | | | | | |
|---|---|---|---|---|---|---|---|---|---|---|
| 1-10 | 91 | 82 | 73 | 64 | 55 | 45 | 36 | 27 | 18 | 9 |
| 11 | 0 | | | | | | | | | |

Completing and Matching Volume Equations Name: **Answer Key**

**Match each problem with the equation that could represent it. Answer with the missing term and letter.**

**Ex)** 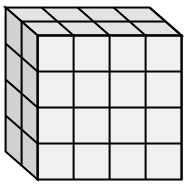

**1)** 

**2)** 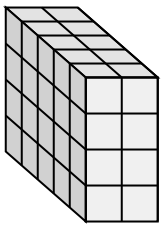

**3)** 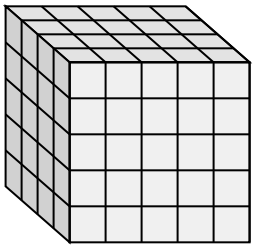

**4)** 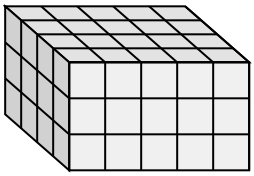

**5)** 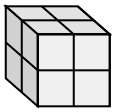

**6)** 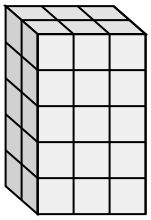

**7)** 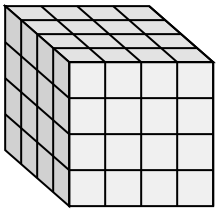

**8)** 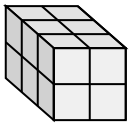

**9)** 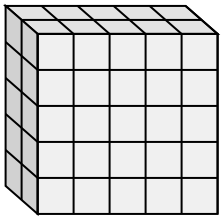

**10)** 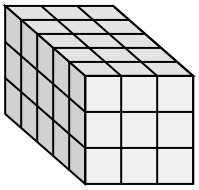

**11)** 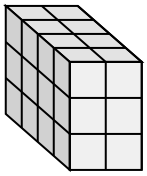

**A.** 4 × 5 × 3 = ___

**B.** 4 × ___ × 3 = 24

**C.** 2 × 3 × 5 = ___

**D.** ___ × 2 × 2 = 12

**E.** ___ × 5 × 5 = 50

**F.** ___ × 3 × 3 = 45

**G.** 5 × ___ × 4 = 40

**H.** 5 × 3 × 5 = ___

**I.** 4 × ___ × 4 = 64

**J.** 2 × ___ × 4 = 32

**K.** 4 × ___ × 5 = 100

**L.** 2 × ___ × 2 = 8

## Answers

| | |
|---|---|
| Ex. | J , 4 |
| 1. | H , 75 |
| 2. | G , 2 |
| 3. | K , 5 |
| 4. | A , 60 |
| 5. | L , 2 |
| 6. | C , 30 |
| 7. | I , 4 |
| 8. | D , 3 |
| 9. | E , 2 |
| 10. | F , 5 |
| 11. | B , 2 |



| | | | | | | | | | | |
|---|---|---|---|---|---|---|---|---|---|---|
| 1-10 | 91 | 82 | 73 | 64 | 55 | 45 | 36 | 27 | 18 | 9 |
| 11 | 0 | | | | | | | | | |