Completing and Matching Volume Equations Name:

Match each problem with the equation that could represent it. Answer with the missing term and letter.

Ex) 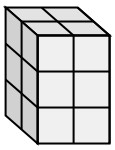

1) 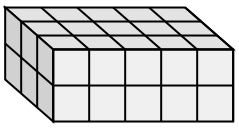

2) 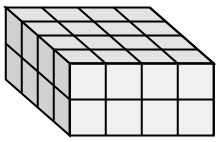

3) 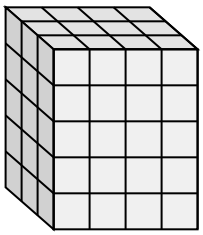

4) 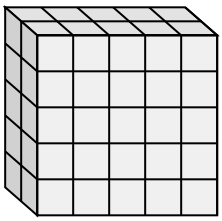

5) 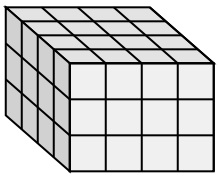

6) 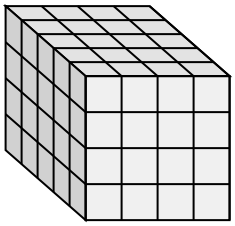

7) 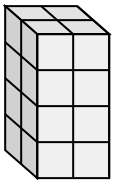

8) 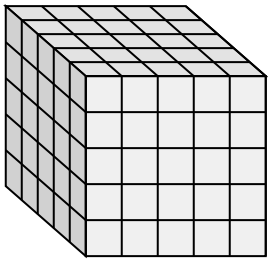

9) 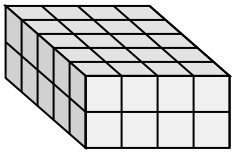

10) 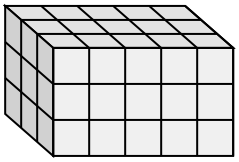

11) 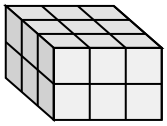

A. ___ × 4 × 3 = 48

B. ___ × 5 × 5 = 125

C. ___ × 5 × 3 = 45

D. 2 × 2 × 3 = ___

E. 3 × ___ × 2 = 18

F. 3 × ___ × 2 = 30

G. 2 × ___ × 4 = 16

H. 2 × 5 × ___ = 50

I. 4 × 4 × ___ = 32

J. ___ × 4 × 2 = 40

K. 3 × 4 × ___ = 60

L. ___ × 4 × 4 = 80

Answers

Ex. D , 12

1. _____

2. _____

3. _____

4. _____

5. _____

6. _____

7. _____

8. _____

9. _____

10. _____

11. _____

1-10	91	82	73	64	55	45	36	27	18	9
11	0									

Completing and Matching Volume Equations Name: **Answer Key**

Match each problem with the equation that could represent it. Answer with the missing term and letter.

Ex) 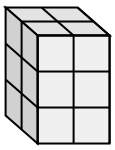

1) 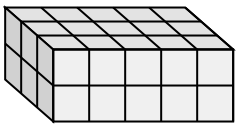

2) 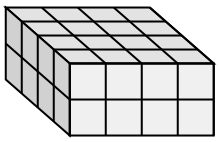

3) 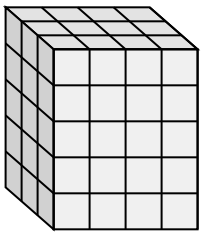

4) 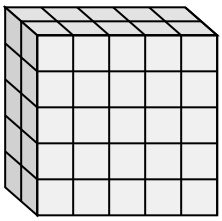

5) 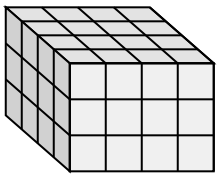

6) 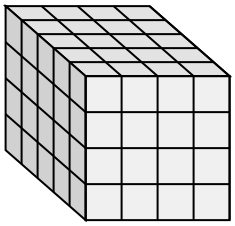

7) 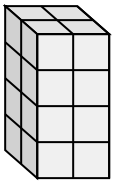

8) 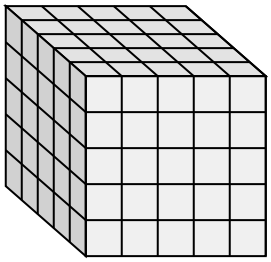

9) 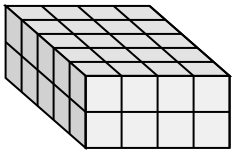

10) 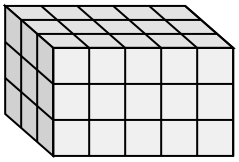

11) 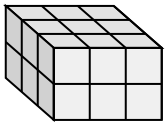

A. ___ × 4 × 3 = 48

B. ___ × 5 × 5 = 125

C. ___ × 5 × 3 = 45

D. 2 × 2 × 3 = ___

E. 3 × ___ × 2 = 18

F. 3 × ___ × 2 = 30

G. 2 × ___ × 4 = 16

H. 2 × 5 × ___ = 50

I. 4 × 4 × ___ = 32

J. ___ × 4 × 2 = 40

K. 3 × 4 × ___ = 60

L. ___ × 4 × 4 = 80

Answers

Ex. **D , 12**

1. **F , 5**
2. **I , 2**
3. **K , 5**
4. **H , 5**
5. **A , 4**
6. **L , 5**
7. **G , 2**
8. **B , 5**
9. **J , 5**
10. **C , 3**
11. **E , 3**

1-10	91	82	73	64	55	45	36	27	18	9
11	0									