Fraction Quantity Relative to Whole

Name:

Solve each problem.

Ex) Express the moons as a fraction of the entire set.

1) Express the stars as a fraction of the entire set.

2) Express the squares as a fraction of the entire set.

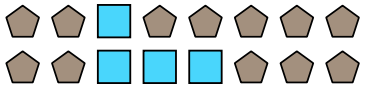

3) Express the hearts as a fraction of the entire set.



4) Express the stars as a fraction of the entire set.



5) Express the hearts as a fraction of the entire set.



6) Express the moons as a fraction of the entire set.

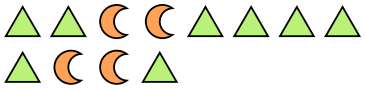

7) Express the squares as a fraction of the entire set.

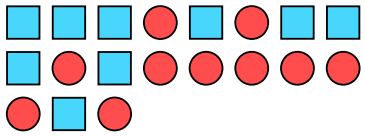

8) Express the stars as a fraction of the entire set.

9) Express the triangles as a fraction of the entire set.

10) Express the circles as a fraction of the entire set.

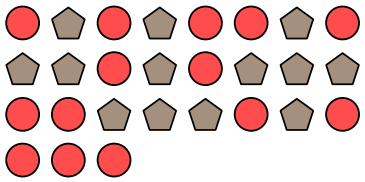

11) Express the stars as a fraction of the entire set.



Answers

Ex. 15/22

1. _____
2. _____
3. _____
4. _____
5. _____
6. _____
7. _____
8. _____
9. _____
10. _____
11. _____

1-10	91	82	73	64	55	45	36	27	18	9
11	0									

Fraction Quantity Relative to Whole

Name: **Answer Key**

Solve each problem.

Ex) Express the moons as a fraction of the entire set.

1) Express the stars as a fraction of the entire set.

2) Express the squares as a fraction of the entire set.

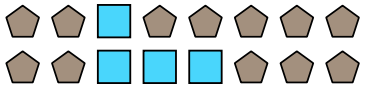

3) Express the hearts as a fraction of the entire set.



4) Express the stars as a fraction of the entire set.



5) Express the hearts as a fraction of the entire set.



6) Express the moons as a fraction of the entire set.

7) Express the squares as a fraction of the entire set.

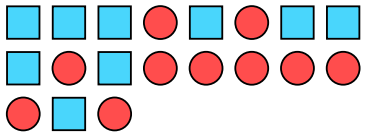

8) Express the stars as a fraction of the entire set.

9) Express the triangles as a fraction of the entire set.

10) Express the circles as a fraction of the entire set.

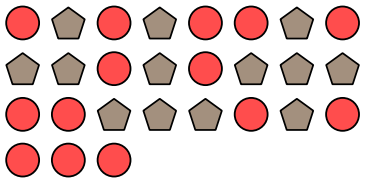

11) Express the stars as a fraction of the entire set.



Answers

Ex.	15/22
1.	3/13
2.	4/16
3.	6/9
4.	2/17
5.	9/19
6.	4/12
7.	9/19
8.	2/10
9.	6/11
10.	14/27
11.	7/17

1-10	91	82	73	64	55	45	36	27	18	9
11	0									