Improper and Mixed Fractions Visual

Name:

Write each amount as a mixed number.

1)

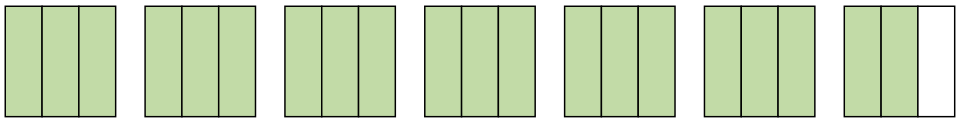

2)

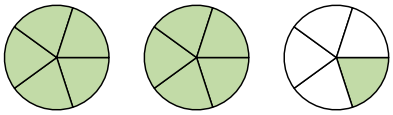

3)

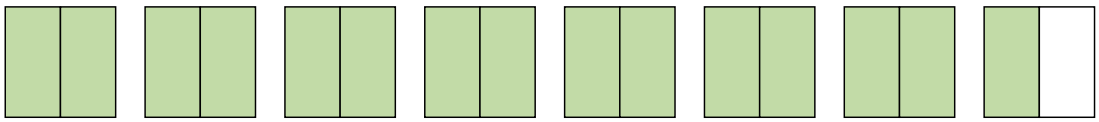

4)



5)



Write each amount as an improper fraction.

6)



7)

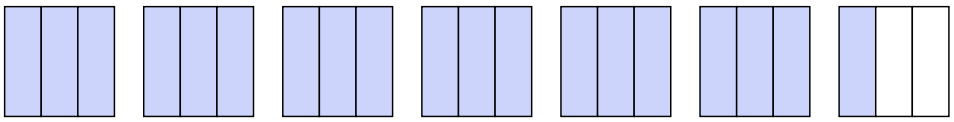

8)

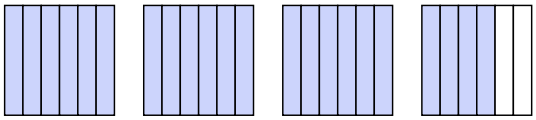

9)

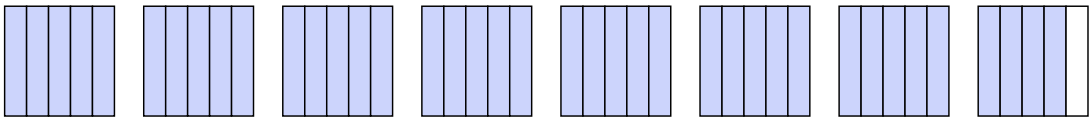

10)

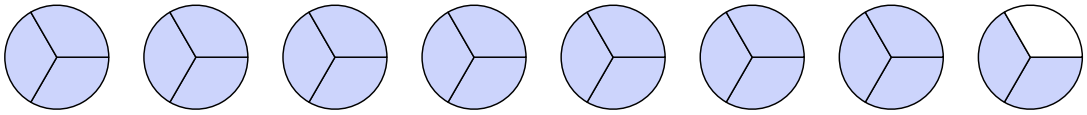

11)

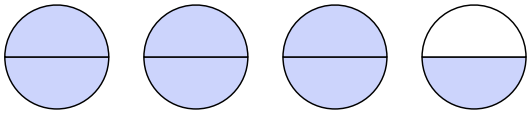

Answers

1. _____
2. _____
3. _____
4. _____
5. _____
6. _____
7. _____
8. _____
9. _____
10. _____
11. _____

1-10	91	82	73	64	55	45	36	27	18	9
11	0									

Improper and Mixed Fractions Visual

Name: **Answer Key**

Write each amount as a mixed number.

1) 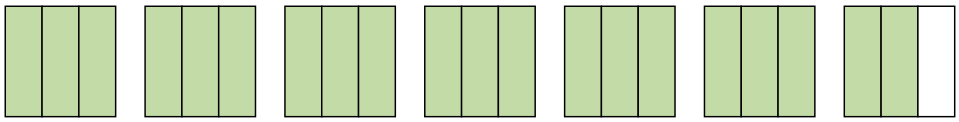

2) 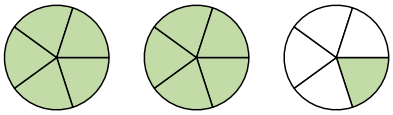

3) 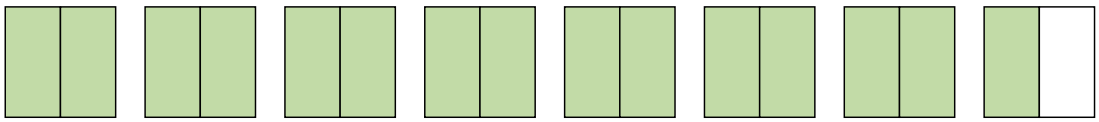

4) 

5) 

Write each amount as an improper fraction.

6) 

7) 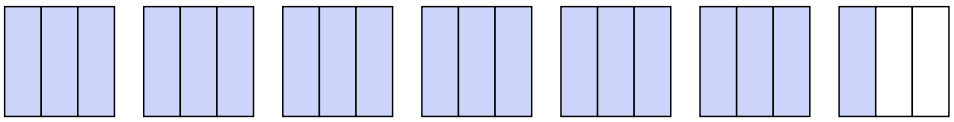

8) 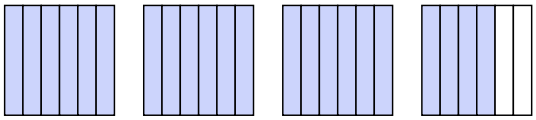

9) 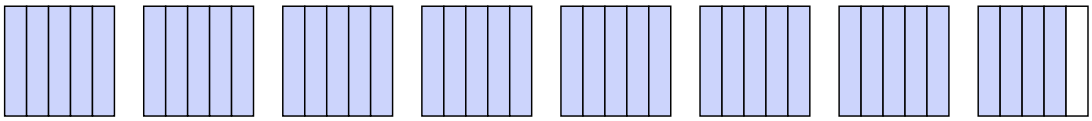

10) 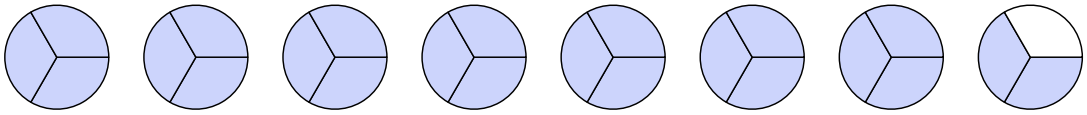

11) 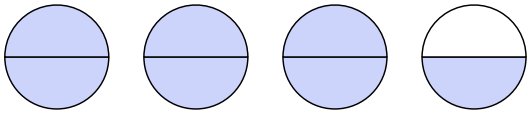

Answers

1. $6\frac{2}{3}$
2. $2\frac{1}{5}$
3. $7\frac{1}{2}$
4. $4\frac{1}{3}$
5. $2\frac{1}{2}$
6. $\frac{13}{2}$
7. $\frac{19}{3}$
8. $\frac{22}{6}$
9. $\frac{39}{5}$
10. $\frac{23}{3}$
11. $\frac{7}{2}$

1-10	91	82	73	64	55	45	36	27	18	9
11	0									