Function Machines (Add & Subtract) Name:

Determine the rule each function machine is using.

Ex)

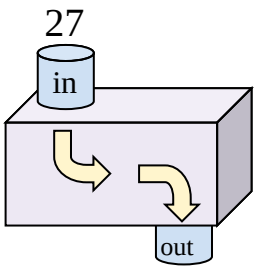

Subtract 5

1)

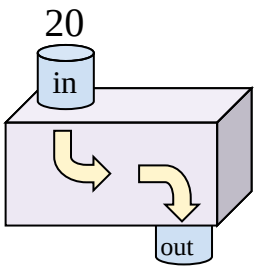

2)

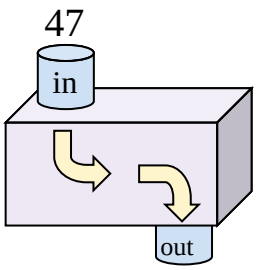

3)

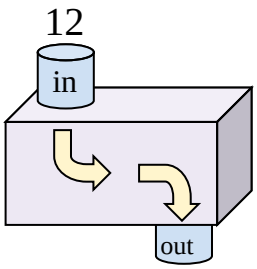

4)

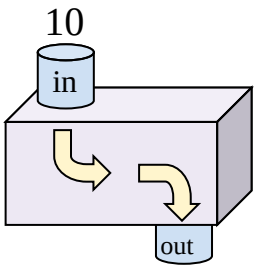

5)

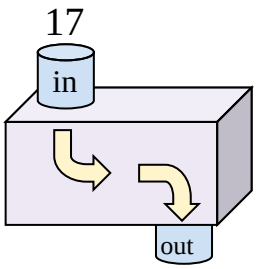

6)

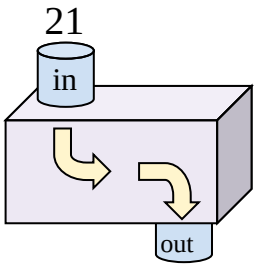

7)

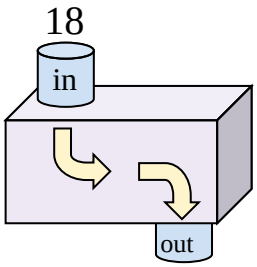

8)

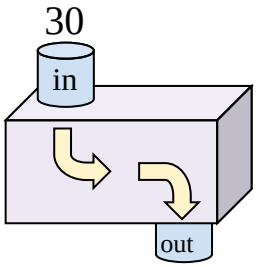

9)

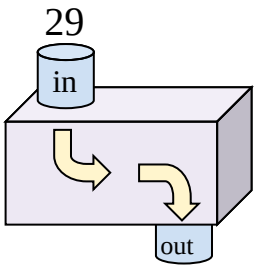

10)

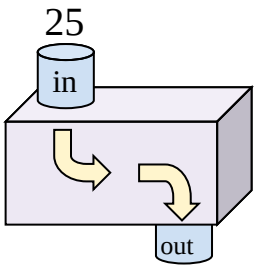

11)

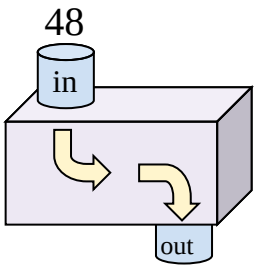

Answers

Ex. Subtract 5

1. _____
2. _____
3. _____
4. _____
5. _____
6. _____
7. _____
8. _____
9. _____
10. _____
11. _____

1-10	91	82	73	64	55	45	36	27	18	9
11	0									

Function Machines (Add & Subtract) Name: **Answer Key**

Determine the rule each function machine is using.

Ex)

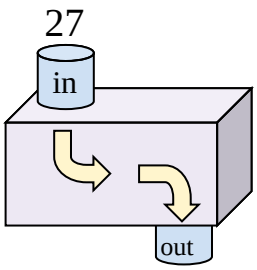

Subtract 5

1)

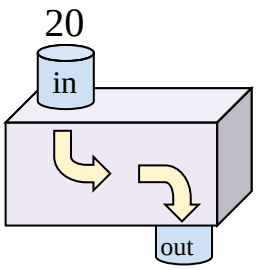

Add 14

2)

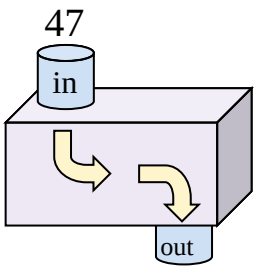

Subtract 33

3)

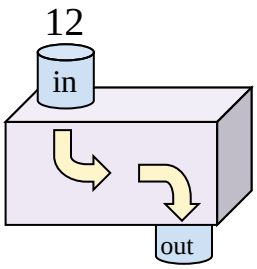

Add 27

4)

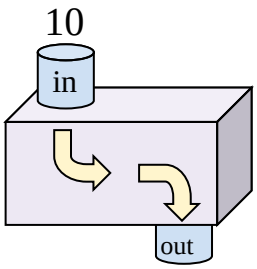

Add 30

5)

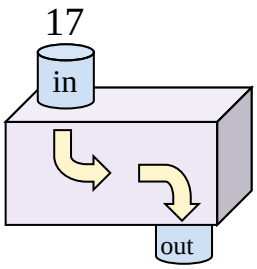

Add 25

6)

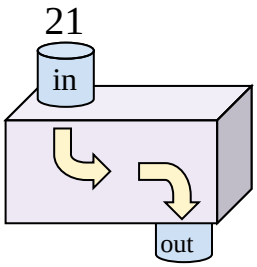

Add 24

7)

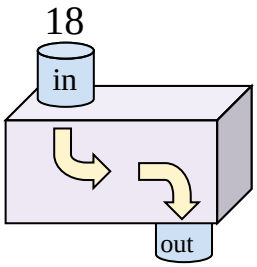

Subtract 12

8)

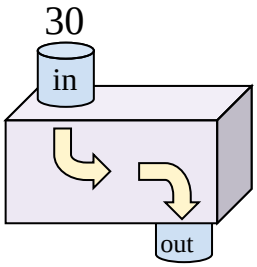

Subtract 6

9)

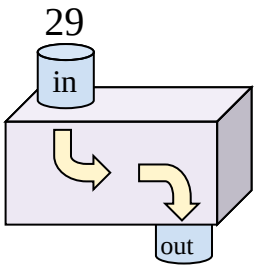

Add 18

10)

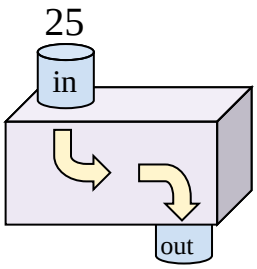

Add 5

11)

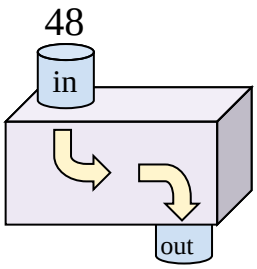

Subtract 31

Answers

Ex.	Subtract 5
1.	Add 14
2.	Subtract 33
3.	Add 27
4.	Add 30
5.	Add 25
6.	Add 24
7.	Subtract 12
8.	Subtract 6
9.	Add 18
10.	Add 5
11.	Subtract 31

1-10	91	82	73	64	55	45	36	27	18	9
11	0									