Function Machines (Add & Subtract) Name:

Determine the rule each function machine is using.

Ex)

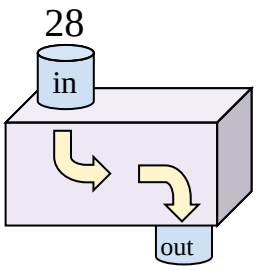

Add 8

1)

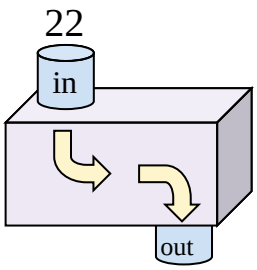

2)

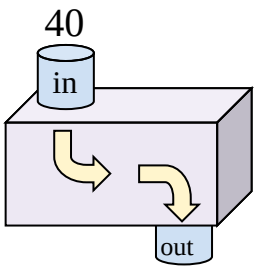

3)

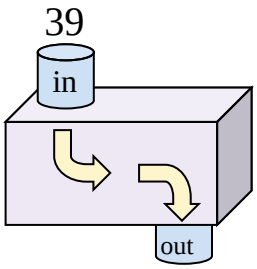

4)

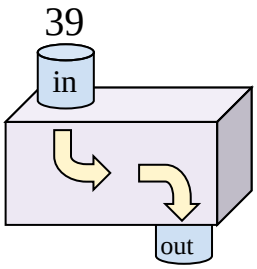

5)

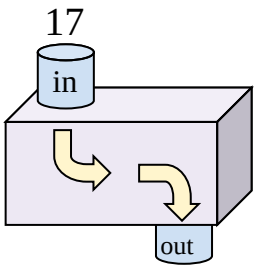

6)

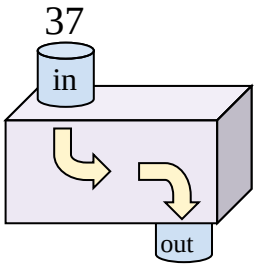

7)

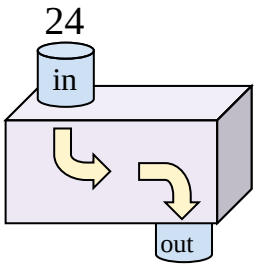

8)

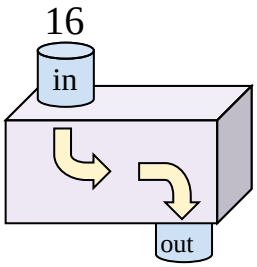

9)

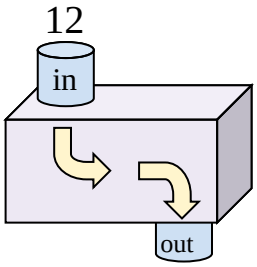

10)

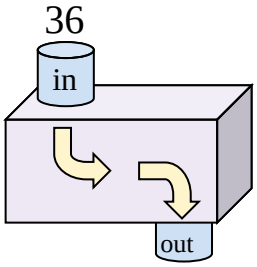

11)

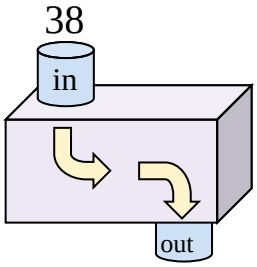

Answers

Ex. Add 8

1. _____
2. _____
3. _____
4. _____
5. _____
6. _____
7. _____
8. _____
9. _____
10. _____
11. _____

1-10	91	82	73	64	55	45	36	27	18	9
11	0									

Function Machines (Add & Subtract) Name: **Answer Key**

Determine the rule each function machine is using.

Ex)

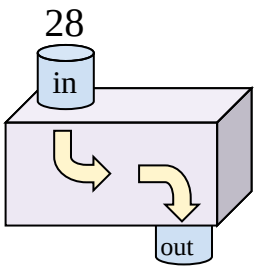

Add 8

1)

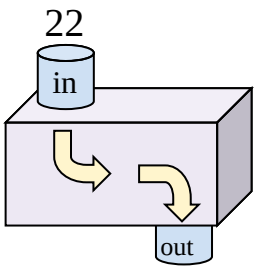

Add 6

2)

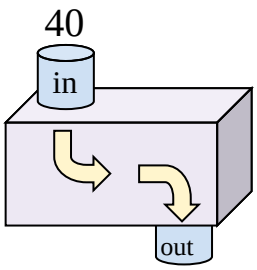

Subtract 16

3)

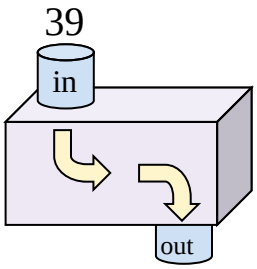

Subtract 17

4)

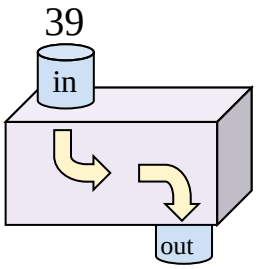

Subtract 32

5)

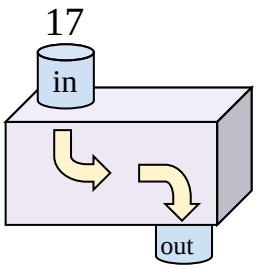

Subtract 6

6)

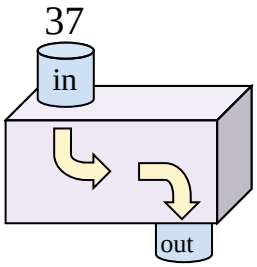

Subtract 14

7)

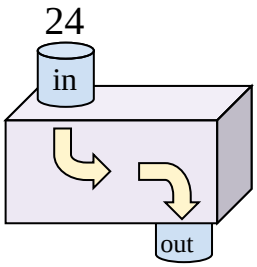

Add 18

8)

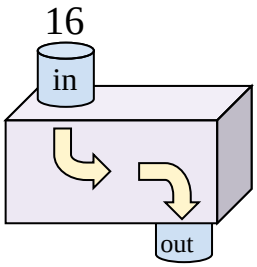

Add 33

9)

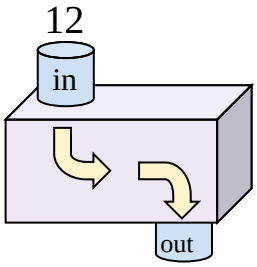

Add 34

10)

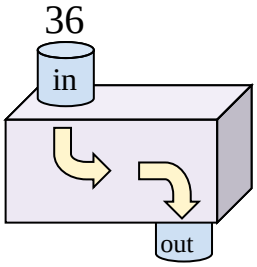

Subtract 26

11)

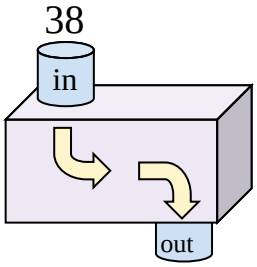

Subtract 9

Answers

Ex.	Add 8
1.	Add 6
2.	Subtract 16
3.	Subtract 17
4.	Subtract 32
5.	Subtract 6
6.	Subtract 14
7.	Add 18
8.	Add 33
9.	Add 34
10.	Subtract 26
11.	Subtract 9

1-10	91	82	73	64	55	45	36	27	18	9
11	0									