Function Machines (Add & Subtract) Name:

Determine the rule each function machine is using.

Ex)

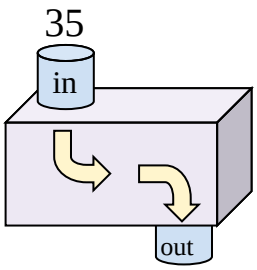

Subtract 13

1)

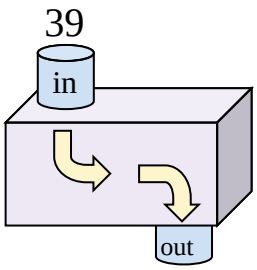

2)

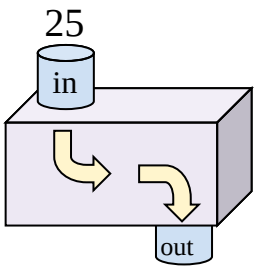

3)

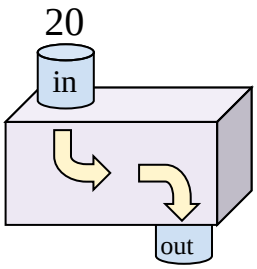

4)

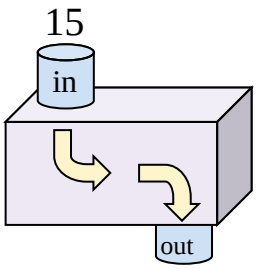

5)

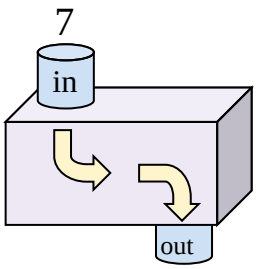

6)

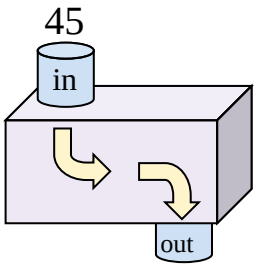

7)

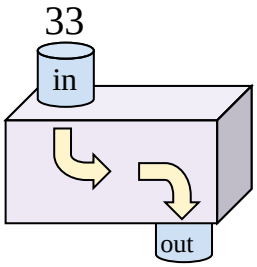

8)

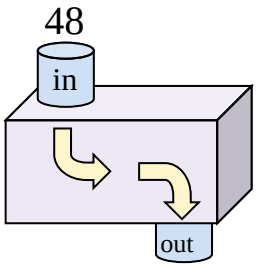

9)

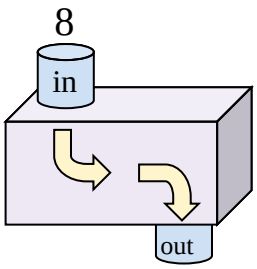

10)

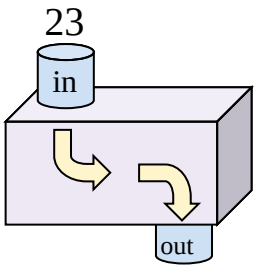

11)

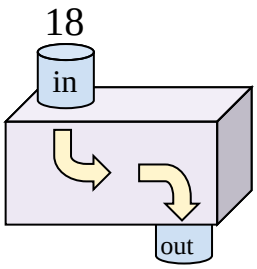

Answers

Ex. Subtract 13

1. _____
2. _____
3. _____
4. _____
5. _____
6. _____
7. _____
8. _____
9. _____
10. _____
11. _____

1-10	91	82	73	64	55	45	36	27	18	9
11	0									

Function Machines (Add & Subtract) Name: **Answer Key**

Determine the rule each function machine is using.

Ex)

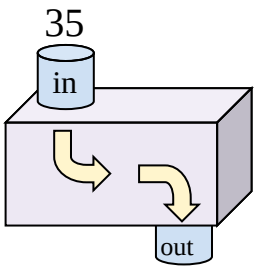

Subtract 13

1)

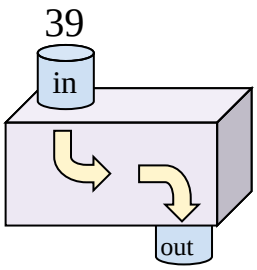

Subtract 31

2)

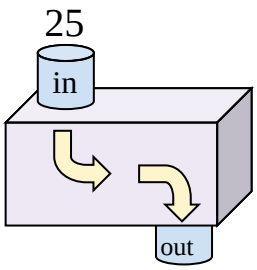

Add 10

3)

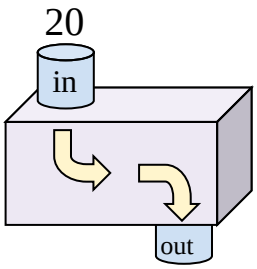

Add 8

4)

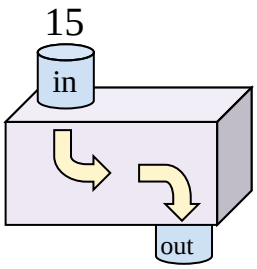

Add 34

5)

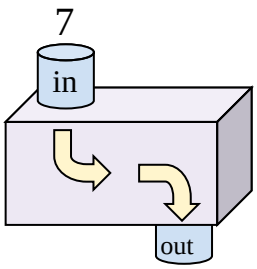

Add 21

6)

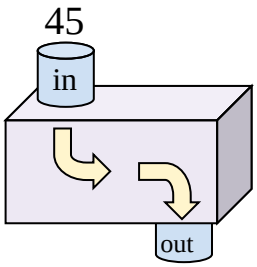

Subtract 21

7)

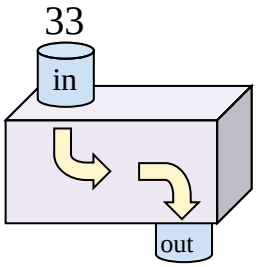

Subtract 13

8)

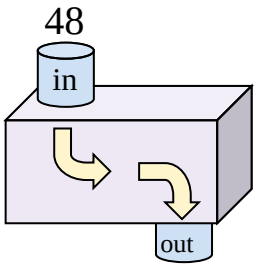

Subtract 28

9)

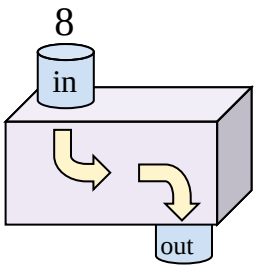

Add 38

10)

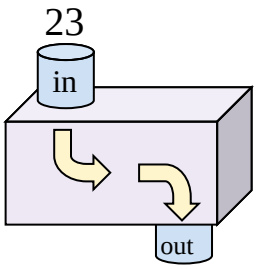

Add 12

11)

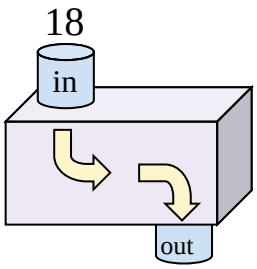

Add 6

Answers

Ex.	Subtract 13
1.	Subtract 31
2.	Add 10
3.	Add 8
4.	Add 34
5.	Add 21
6.	Subtract 21
7.	Subtract 13
8.	Subtract 28
9.	Add 38
10.	Add 12
11.	Add 6

1-10	91	82	73	64	55	45	36	27	18	9
11	0									