Counting Figures Name:

**Count the number of shapes in each box.**



**Ex)** = 3

**1)** = _____

**2)** = _____

**3)** 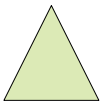 = _____

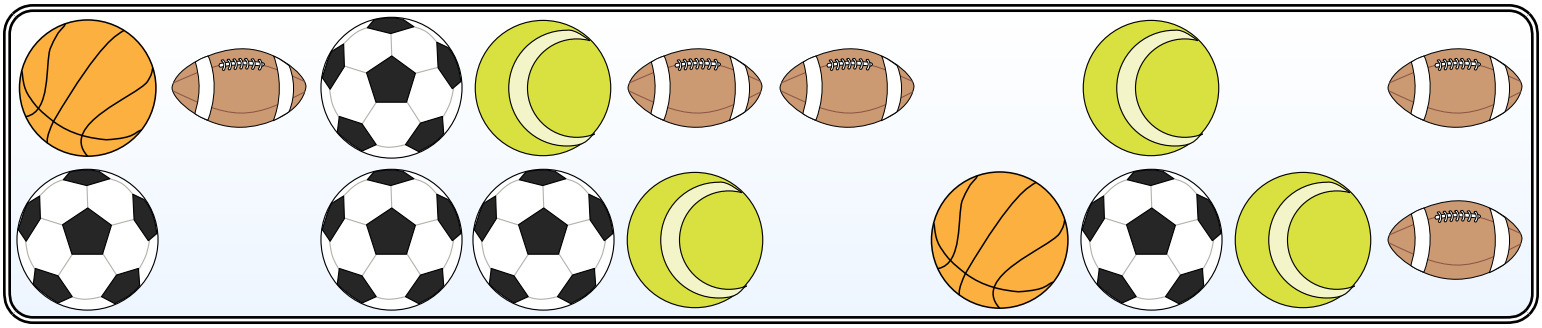

**4)** = _____

**5)** = _____

**6)** = _____

**7)** = _____



**8)** = _____

**9)** = _____

**10)** = _____

**11)** = _____



| | | | | | | | | | | |
|---|---|---|---|---|---|---|---|---|---|---|
| 1-10 | 91 | 82 | 73 | 64 | 55 | 45 | 36 | 27 | 18 | 9 |
| 11 | 0 | | | | | | | | | |

Counting Figures

Name: **Answer Key**

**Count the number of shapes in each box.**



**Ex)** = 3

**1)** = 1

**2)** = 7

**3)** 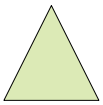 = 5

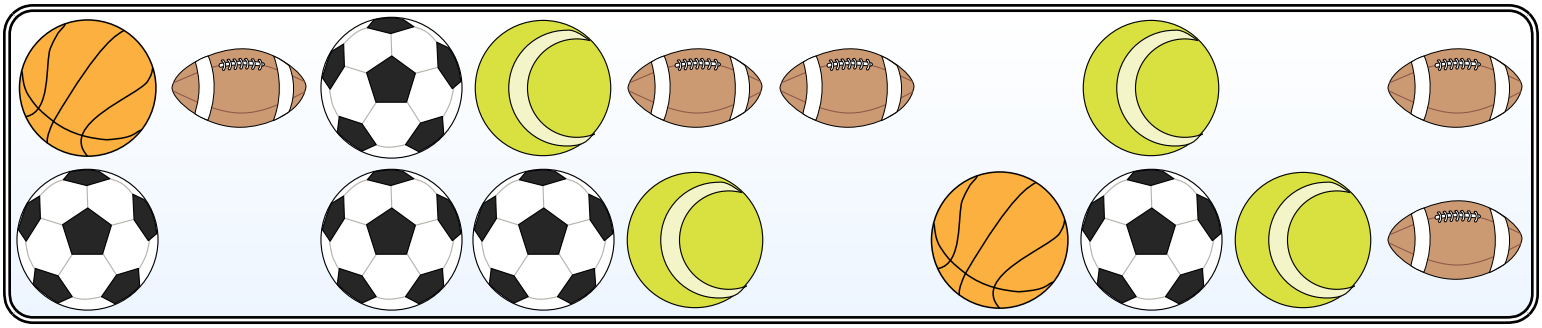

**4)** = 2

**5)** = 5

**6)** = 5

**7)** = 4



**8)** = 4

**9)** = 6

**10)** = 5

**11)** = 4



| | | | | | | | | | | |
|---|---|---|---|---|---|---|---|---|---|---|
| 1-10 | 91 | 82 | 73 | 64 | 55 | 45 | 36 | 27 | 18 | 9 |
| 11 | 0 | | | | | | | | | |